

Señala el número mayor de cada suma y calcúlalas:

FICHAS MATEMÁTICAS DE SUMAS



3 + 5 = ☐

5 + 1 = ☐

5 + 5 = ☐

1 + 8 = ☐

2 + 6 = ☐

4 + 5 = ☐

3 + 4 = ☐

4 + 2 = ☐

2 + 3 = ☐

1 + 2 = ☐

1 + 4 = ☐

3 + 1 = ☐

1 + 1 = ☐

6 + 2 = ☐

9 + 1 = ☐

8 + 2 = ☐

5 + 2 = ☐

4 + 3 = ☐

7 + 6 = ☐

6 + 2 = ☐

5 = 2 = ☐

3 + 7 = ☐

2 + 5 = ☐

6 + 3 = ☐



7 + 3 = ☐

3 + 6 = ☐

6 + 3 = ☐

7 + 1 = ☐

5 + 3 = ☐

8 + 2 = ☐

3 + 6 = ☐

4 + 4 = ☐