

Señala el número mayor de cada suma y calcúlalas:

FICHAS MATEMATICAS DE SUMAS





2 + 8 = ☐

4 + 5 = ☐

3 + 3 = ☐

6 + 3 = ☐

7 + 3 = ☐

5 + 1 = ☐

3 + 4 = ☐

1 + 1 =
2 + 2 =
2 + 1 =
1 + 1 =
2 + 1 =
3 + 1 =
2 + 3 =
2
+3

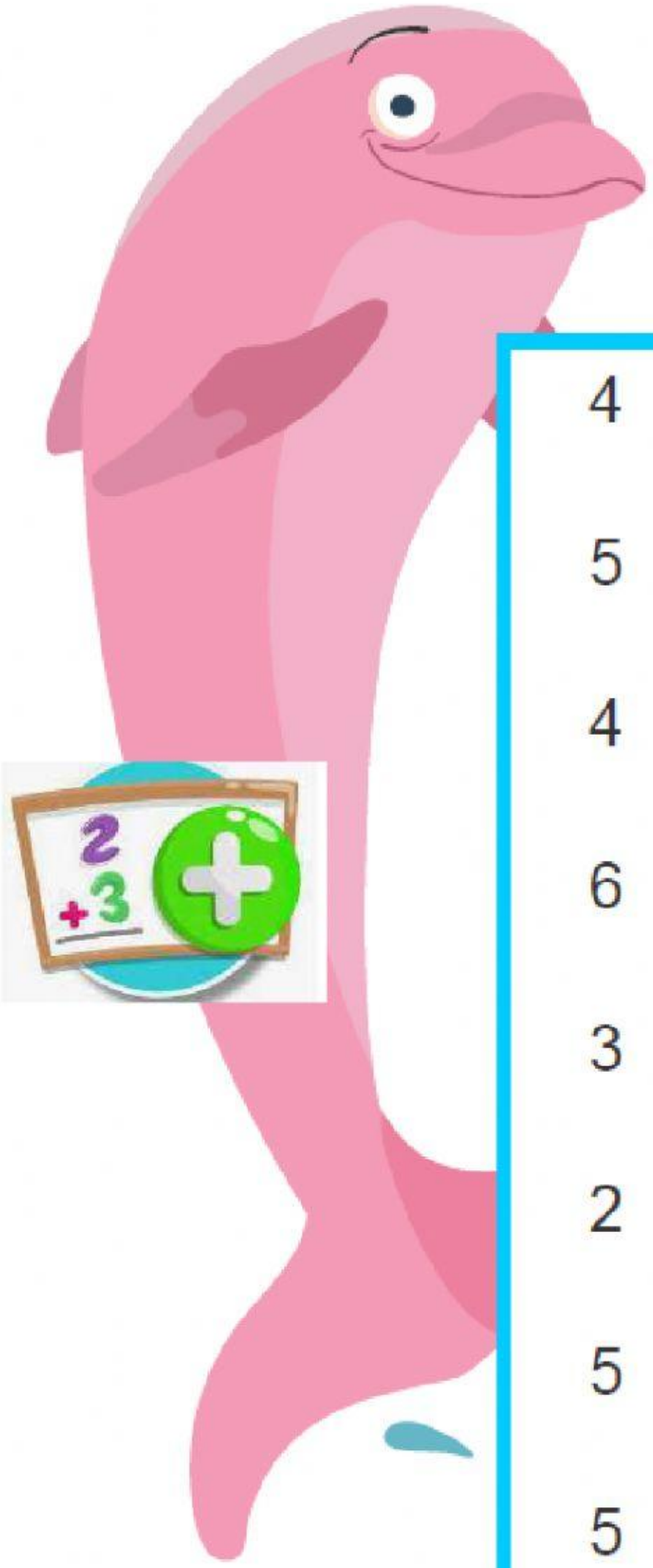

4 + 6 = ☐

5 + 3 = ☐

4 + 2 = ☐

6 + 2 = ☐

3 + 3 = ☐

2 + 7 = ☐

5 + 4 = ☐

5 + 5 = ☐