Student Name: _____ Date: _____

Level 1 Question 1

1. Why do objects fall to the ground?

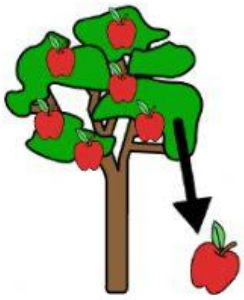

Gravity

Throwing

(Teacher choose one)
CUE/S:

"Label the picture of what cause things to fall to the ground?"
"Identify the image of what allows objects to fall."
"Name the thing that allows things to fall down."

1

Student Name: _____Date: _____

Level 1 Question 2

2. Why is it easier to pull a wagon on a sidewalk than on grass?

Heavy

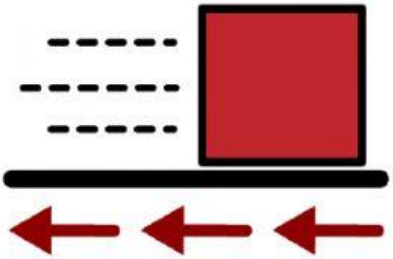

Friction

(Teacher choose one)

CUE/S: "Label the picture that best answer the question."
"Identify the picture that makes it easier to pull a wagon on the sidewalk."
"Can you name the that helps you to understand why an item is easy to pull on one
service over another?"

2

Student Name: _____ Date: _____

Level 1 Question 3

3. What is an example of something that can be used to create renewable energy?



Rock



Solar Panel

(Teacher choose one)

CUE/S: "Label the image that represent a renewable energy."
"Identify the image of energy that can be used again."
"Can you name the picture above that displays something that is used for renewable energy?"

Level 1 Question 4

Student Name: _____ Date: _____

4. A push or pull is described as…

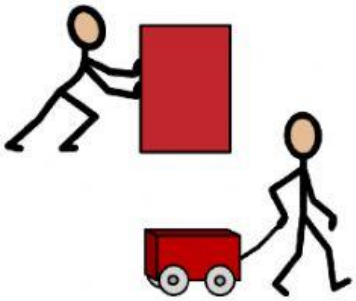

Forces

Energy Bar

(Teacher choose one)

CUE/S: "Label the symbol that shows a push or a pull."
"Identify the picture of a push or pull."
"Can you name the picture of what is identified as a push or pull?"

4