חזרה לבוחן- זוויות צמודות וקודקודיות

1.באיזה סרטוט ? α ו β -הן זוויות צמודות. נא לסמן V ליד זוויות צמודות.

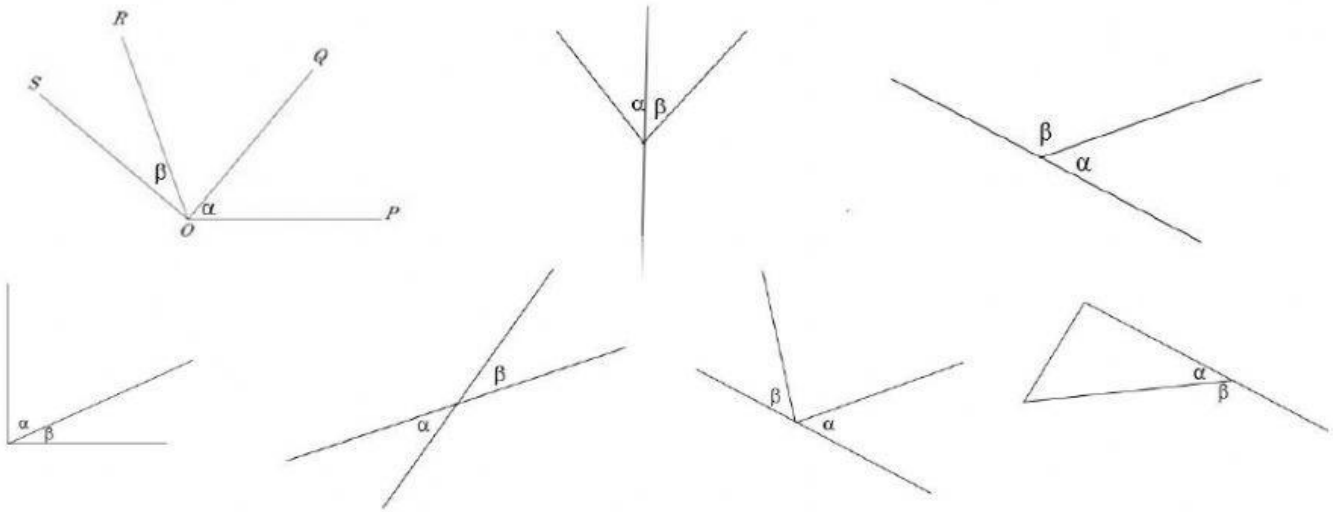

2. מצאו את α בתרגילים הבאים .

א.

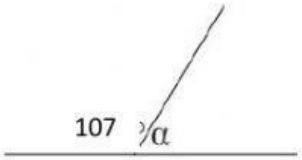

α =

ב.

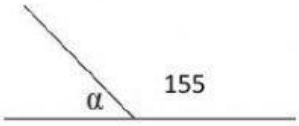

α =

ד.

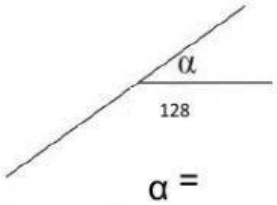

α =

ה.

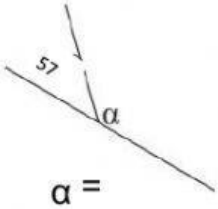

α =

3. ציינו לגבי α ו-β אם הן זוויות צמודות, זוויות קדקודיות או זוויות לא צמודות ולא קדקודיות.

א.
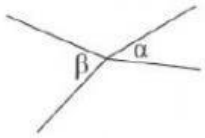

ב.
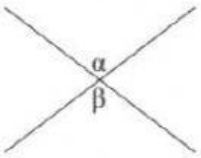

ג.
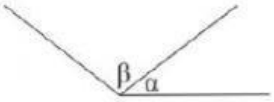

ד.
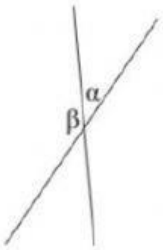

ה.
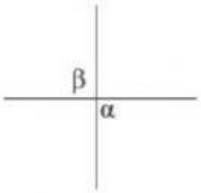

ו.
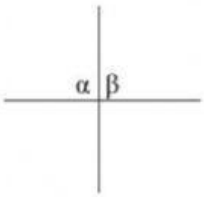

4. חשבו את הזוויות γ, β, α הנוצרות על-ידי חיתוך של קווים ישרים.

א.
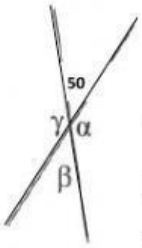

α=

β=

γ=

ב.
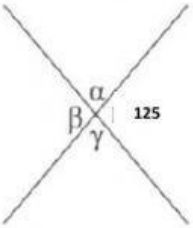

α=

β=

γ=

ד.
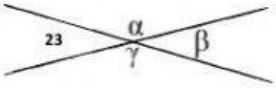

α=

β=

γ=

ה.
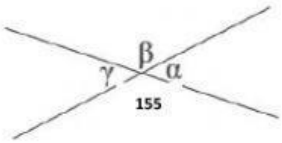

α=

β=

γ=