# Fractions

## 1.Write the unshaded and shaded part of each fraction

| Fraction | What part is shaded? | What part is unshaded? |
|---|---|---|
| | | |
| | | |
|  | | |
| | | |
| | | |
| | | |

| Fraction | What part is shaded? | What part is unshaded? |
|---|---|---|
| | | |
| | | |
| 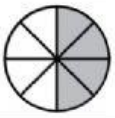 | | |
| | | |
| | | |
| | | |

## 2. Write the shaded part of each fraction

| | | |
|---|---|---|
| _____ |  _____ |  _____ |
|  _____ | _____ |  _____ |
|  _____ | _____ |  _____ |