LEMBAR KERJA SISWA

IPA

NAMA: **KELAS:** **NO.ABSEN:**

AYO HUBUNGKAN GAMBAR ORGAN PENCERNAAN DENGAN FUNGSI YANG SESUAI!

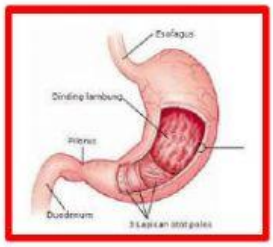

Menyerap sari-sari makanan

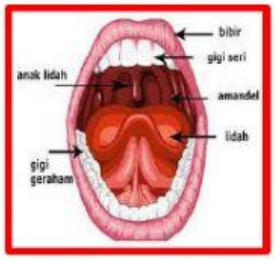

Mendorong makanan ke lambung

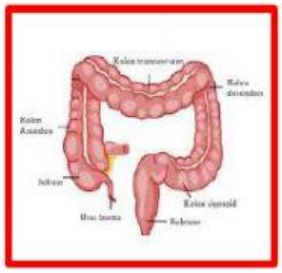

Penghasil enzim pepsin, renin, dan HCL

Penghancuran makanan tahap pertama

Menyerap air dan mineral