AL AWAEL
AL AWAEL PRIVATE SCHOOLS CO.LTD.
UNIQUENESS OF CREATIVITY SINCE 1420 H

وزارة التعليم
Ministry of Education

AiAA

Worksheet (Science)
2020-2021

Student's Name	Grade	Subject	Date	Quarter
	2	science	29-10-	

Parts of plants

1. **Drag the name of parts of plant from below:**

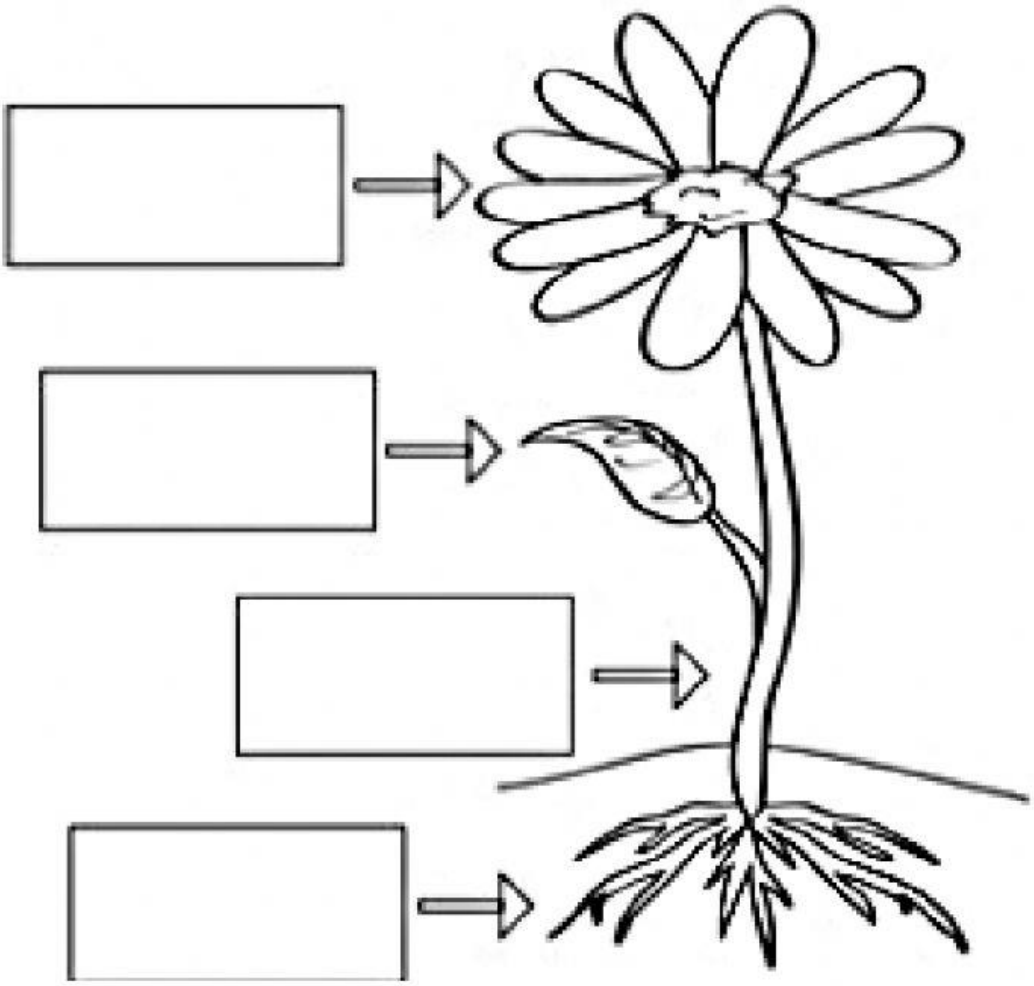

leaf | **root** | **stem** | **flower**

AL AWAEL
AL AWAEL PRIVATE SCHOOLS CO.LTD.
UNIQUENESS OF CREATIVITY SINCE 1420 H

وزارة التعليم
Ministry of Education

AiAA

Worksheet (Science)
2020-2021

What do plants need?

Draw a line from the things which a plant needs to grow to the plant.



Worksheet (Science)
2020-2021

Name: _____

Plant Needs

Help Jack decide what a plant needs.

Drag the item which a plant needs to grow around the happy plant.

Drag the item which a plant doesn't needs to grow beside the unhappy plant.



© United Teaching 2016