Tens and Units

Write how many tens and units.

Then write the whole number.



= 1 tens 3 units = 13



= ____ tens ____ units = _____



= ____ tens ____ units = _____

Thursday 29th October 2020

Maths



= _____ tens _____ units = _____

= _____ tens _____ units = _____



= _____ tens _____ units = _____



= _____ tens _____ units = _____

Ms Lisa Micallef