ÁREAS Y VOLÚMENES 2

Calcular el área de la base, área lateral, área total y el volumen de las siguientes figuras:

1.-

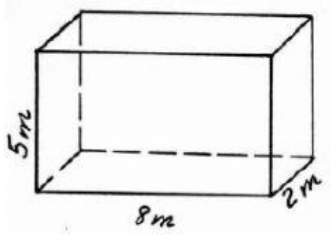

2.-

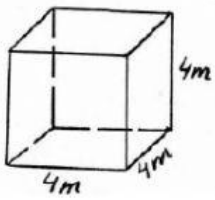

3.-

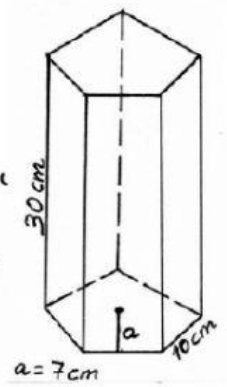

4.-

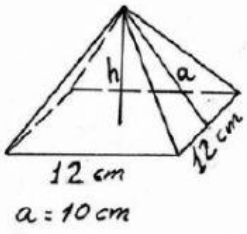

5.

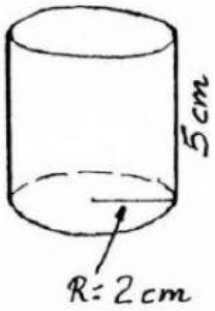

6.

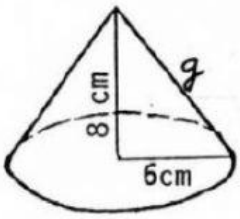

7.

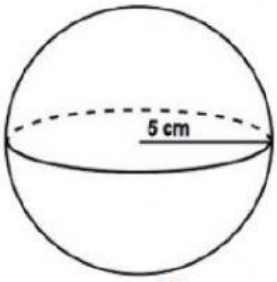

8.

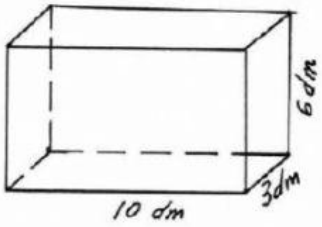

9.

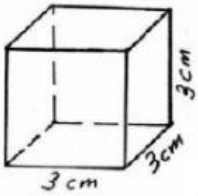

10.

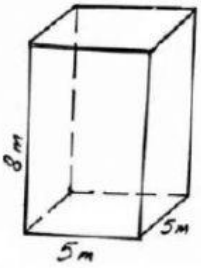

11.

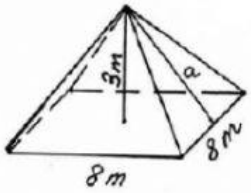

12.

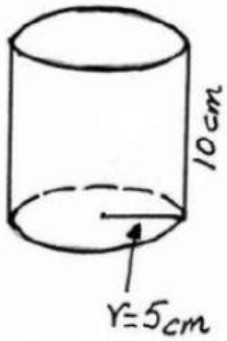

13.

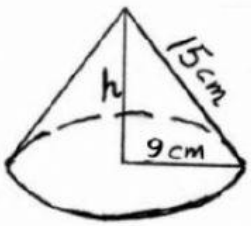

14.

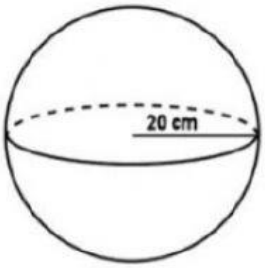

Respuestas

En las áreas y volúmenes en los que intervenga π , no multipliques por 3,14.
Deja el resultado como un número por π. Por ejemplo 236π

	Área base	Área lateral	Área total	Volumen
Figura 1				
Figura 2				
Figura 3				
Figura 4				
Figura 5	π	π	π	π
Figura 6	π	π	π	π
Figura 7			π	π
Figura 8				
Figura 9				
Figura 10				
Figura 11				
Figura 12	π	π	π	π
Figura 13	π	π	π	π
Figura 14			π	π