FUNÇÃO DE 1° GRAU

RELACIONE A FUNÇÃO AO GRÁFICO

x	y =2x +5	y	Par Ordenado (x,y)
1	Y= 2.1 +5	7	(1,7)
2	Y= 2.2 +5	9	(2,9)
3	Y= 2.3 +5	?	(?,?)

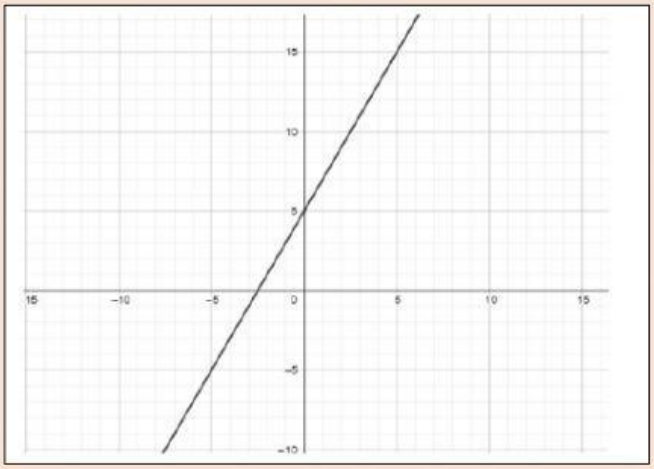

x	y = x +22	y	Par Ordenado (x,y)
1	Y= 1 + 22	23	(1,23)
2	Y= 2 + 22	24	(2,24)
3	Y= 3 + 22	?	(?,?)

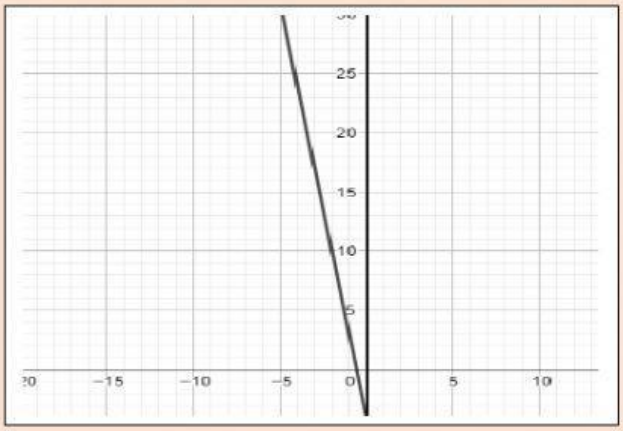

x	y = - 7x -4	y	Par Ordenado (x,y)
1	Y= - 7.1 -4	-11	(1,-11)
2	Y= - 7.2 -4	-18	(2,-18)
3	Y= - 7.3 -4	?	(?,?)

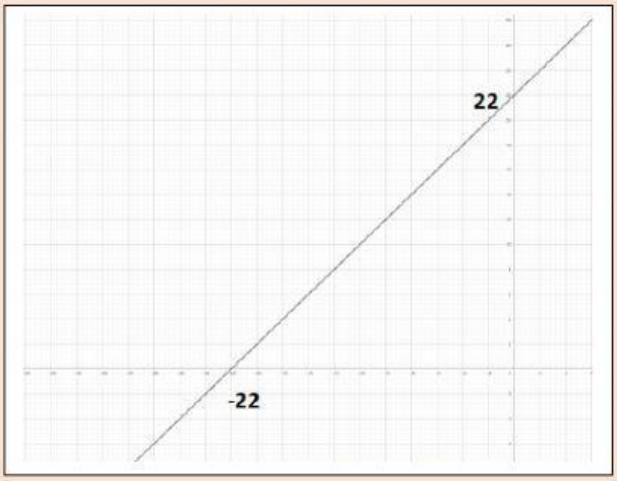
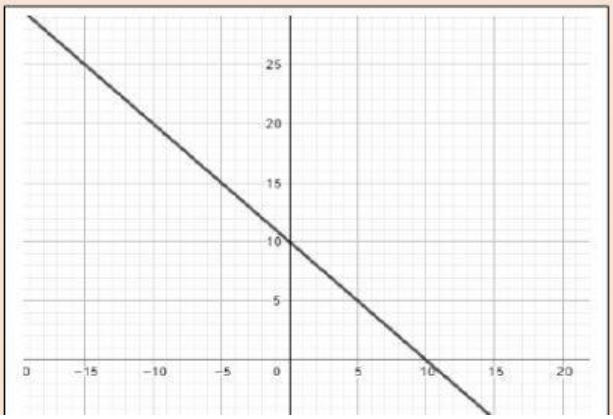
x	y = -x + 10	y	Par Ordenado (x,y)
1	Y= - 1 + 10	9	(1,9)
2	Y= -2 + 10	8	(2,8)
3	Y= -3 + 10	?	(?,?)