Aluno (a) _____

Professora _____Data: _____/_____/_____

1) Observe as cédulas e selecione a opção que indica a quantidade correta.



( ) 35 REAIS
( ) 15 REAIS
( ) 25 REAIS



( ) 10 REAIS
( ) 9 REAIS
( ) 11 REAIS



( ) 15 REAIS
( ) 10 REAIS
( ) 12 REAIS



( ) 4 REAIS
( ) 5 REAIS
( ) 3 REAIS

2) Relacione os cofrinhos com a quantia correta que há dentro deles.

18 centavos

95 centavos

88 centavos

41 centavos

3) Fui a loja e comprei uma mochila por R$ 43,00 e paguei com uma cédula de Quanto recebi de troco?

a) R$ 10,00

b) R$ 9,00

c) R$ 7,00

d) R$ 6,00