Tipos de Rectas: Rectas Paralelas o Perpendiculares
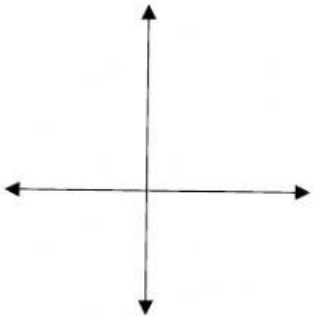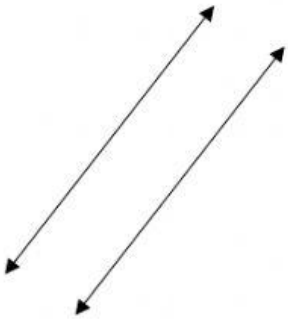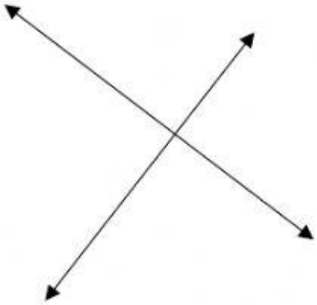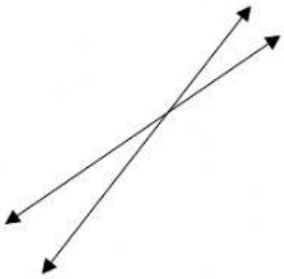
Observa los dibujos y selecciona para cada uno de ellos: Rectas Paralelas, Rectas Perpendiculares o Ninguna de las anteriores.