Name: _____

Prime Factorization

Complete the working then express the numbers as a product of their prime factors.

a)

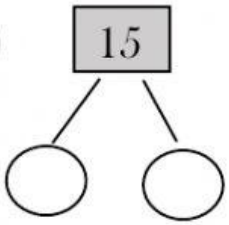

15 = __ x __

b)

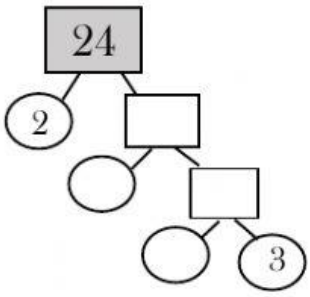

24 = __ x __ x __ x __

c)

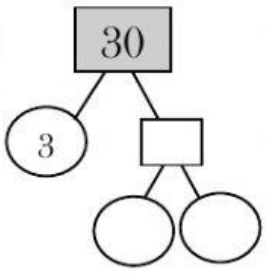

30 = __ x __ x __

d)

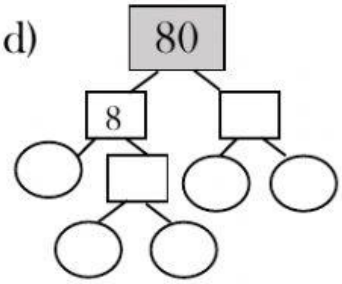

80 = __ x __ x __ x __ x __

e)

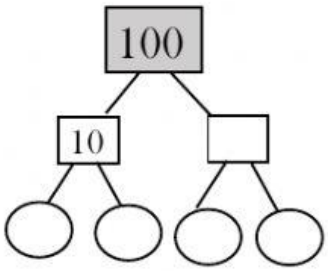

100 = __ x __ x __ x __