Name _____

Add the two groups of coins.



plus

+



equal

=



plus

+

equal

=



plus

+



equal

=



plus

+



equal

=

plus

+



equal

=