Write the decimals for the shaded portions:





3 .Write decimals for the following fractions:

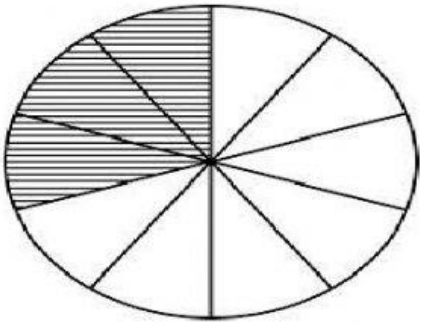



Q1.Convert into decimals:

a) 5/10 = _____

b) 75/100 = _____

Q2. Convert into Fractions :

a) 0.34 = _____

b) 0.78 = ……....