Compara las fracciones <, > o = y ubicalas en la recta numérica.

$\frac{4}{5}$ ☐ $\frac{3}{4}$

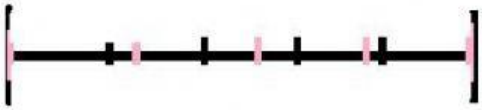

$\frac{8}{16}$ ☐ $\frac{4}{8}$

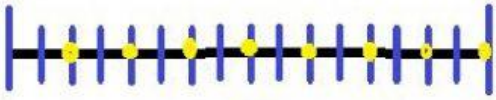

$\frac{3}{8}$ ☐ $\frac{1}{2}$

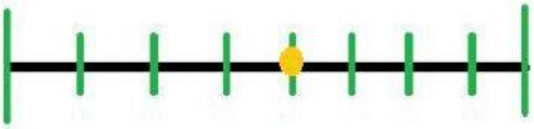
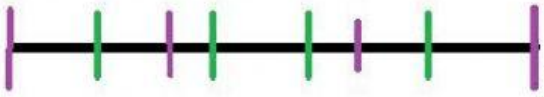
$\frac{2}{3}$ ☐ $\frac{4}{5}$