KENDRIYA VIDYALAYA SANGATHAN

AHMEDABAD REGION

PRIMARY TEACHERS' INSERVICE COURSE SPELL-II (2020)

CLASS-4 NAME- ----------

SUBJECT-MATHS ROLL NO. --------

TOPIC-HALVES AND QUARTERS

COMPETENCY-KNOWLEDGE

Q1.In the following, fill in the blanks. First one is done for you.

(i) 3/5 , 5 is denominator, 3 is numerator

(ii) 8/9, ◯ is numerator , ◯ is denominator

(iii) 6/8 , ◯ is denominator , ◯ is numerator

(iv) 1/7 , ◯ is denominator , ◯ is numerator

(v) 6/10 , ◯ is denominator , ◯ is numerator

Q2.Colour the given figure according to the fraction given below:

(i) 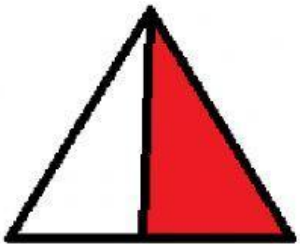

(ii) 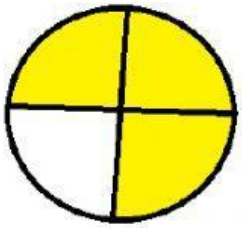

(iii) 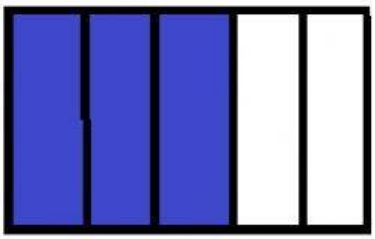



(iv) 

Q3.Write the fractions whose numerator(N) and denominator (D) are as under:

(I) N = 4 ; D = 7 = 4/7

(ii) N = 2 ;D = 5= ☐

(iii) N =5 ; D = 10 = ☐

(iv) N =3 ; D = 5= ☐

(v) N =7 ; D = 9 = ☐