Science **Grade 7**

Parts of the atom

1-Complete the table of parts of the atom:

	Electron	 Proton	 Neutron
Symbol			
Charge			
Location			
Relative mass			

2-atomoic number is……

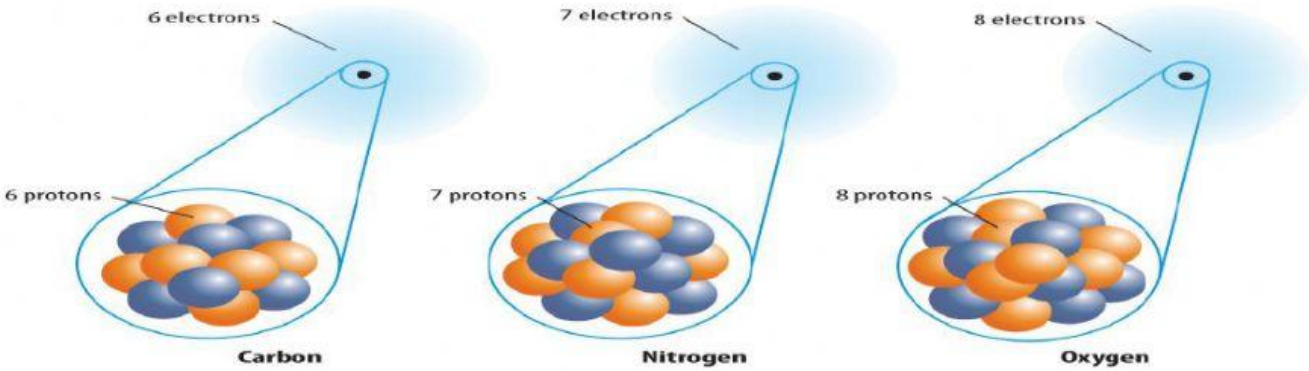

……..

Atomic number of carbon=…….. Atomic number of Nitrogen=…..… Atomic number of Oxygen=…….

Each atoms of different elements have ……

3-In a neutral atom, the number of …… equal the number of ……

Therefore,……...