Identificar la centena

Completar el siguiente recuadro, indicando cuantas centenas, decenas y unidades aparecen en el dibujo.

	C	D	U
	6 C	60 D	600 U
	C	D	U
	C	D	U
	C	D	U
	C	D	U
	C	D	U

Transformar las decenas en decenas o unidades.

1 centenas =	10 decenas
5 centenas =	unidades
9 centenas =	decenas