¡VAMOS A TRABAJAR!

1. Une cada número con la representación que corresponde.

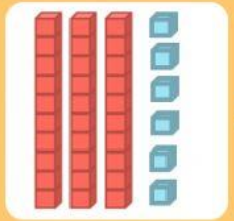



15

40

9

36

21

12



2. ¿Cuántas decenas y unidades hay?

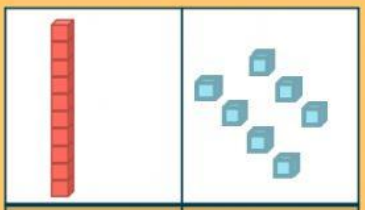

Decenas	Unidades

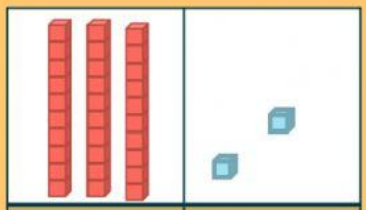

Decenas	Unidades

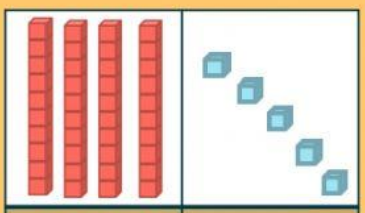

Decenas	Unidades

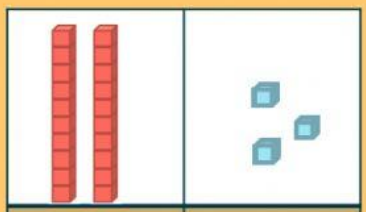

Decenas	Unidades

3. Escribe los números que se forman.

Decenas	Unidades
	

D	U
3	4

34

Decenas	Unidades
	

D	U

Decenas	Unidades

D	U

Decenas	Unidades
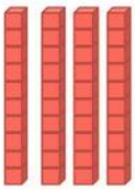	

D	U

4. Marca la cantidad de unidades y decenas para representar el número indicado

13

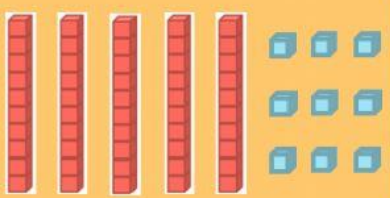

21

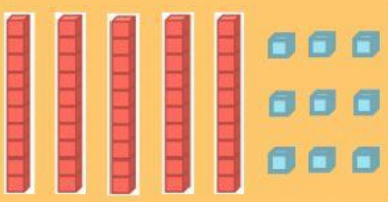

37

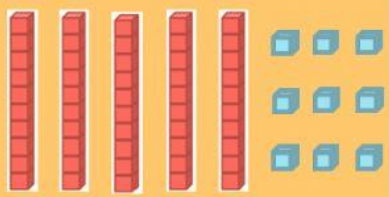
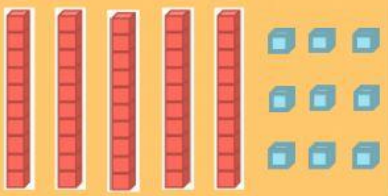
18