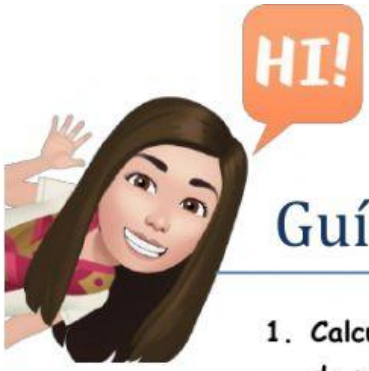

Guía de repaso Geometría parte II

1. **Calcula el perímetro de las siguientes figuras planas. Escribe la unidad de medida seguido del número no hagas espacio (ejemplo: 30cm)**

a.

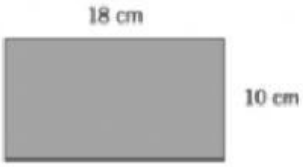

P =

c.

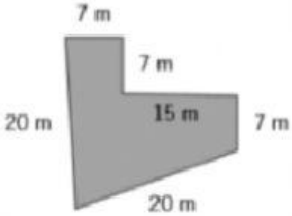

P =

b.

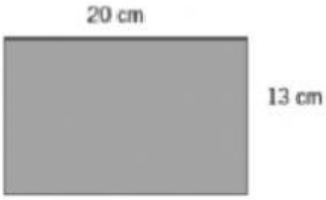

P =

d.

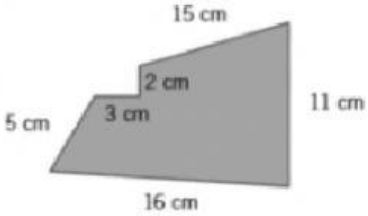

P =

2. **Calcula el área de las siguientes figuras planas. Escribe la unidad de medida seguido del número no hagas espacio y al cuadrado escribe un 2 (ejemplo: 30cm2)**

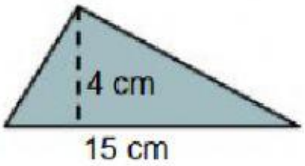

A=



A =

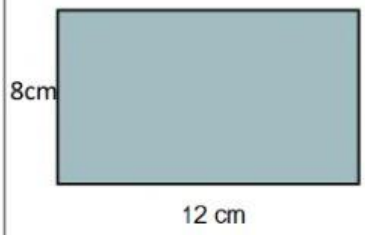

A =

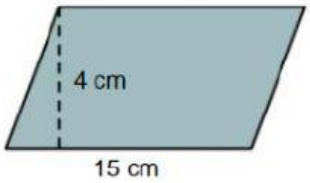

A =

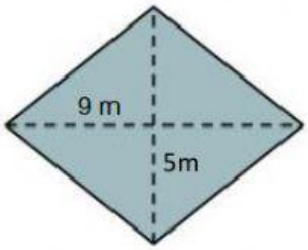

A =

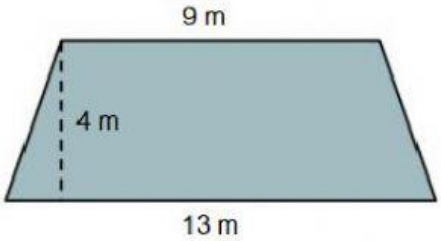

A=

3. **Reconocer pares ordenados (plano cartesiano). Escribe el par ordenado de cada figura.**