Calcular área de los siguientes polígonos

Calcula el área según la formula. Escribe sólo la cantidad, ya que está lista la unidad de medida.

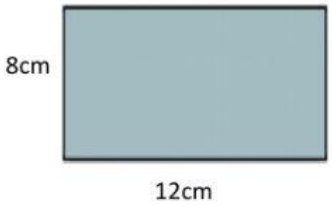

A= _____ cm^2

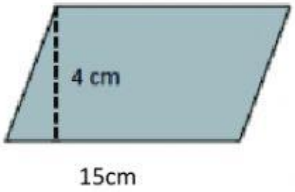

A= _____ cm^2

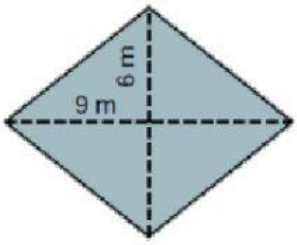

A= _____ m^2

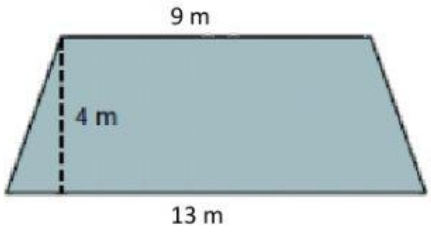

A= _____ m^2