Representación de fracciones: Las figuras y las fracciones de la hoja están desordenadas, reordenalas para que las figuras se encuentren con su fracción correspondiente.



$\frac{6}{10}$



$\frac{3}{4}$

$\frac{2}{9}$

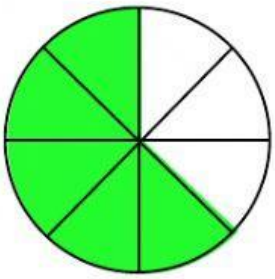

$\frac{4}{7}$

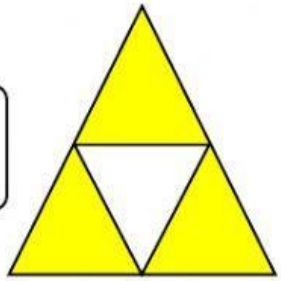

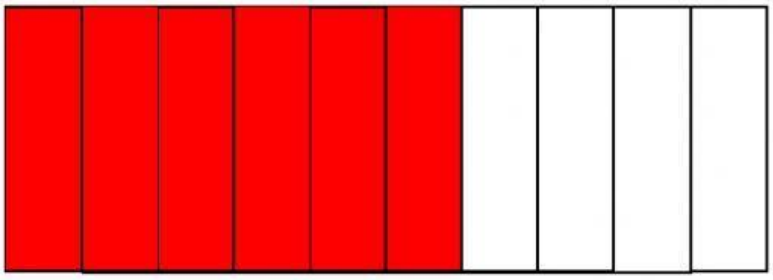

$\frac{7}{12}$

$\frac{5}{8}$

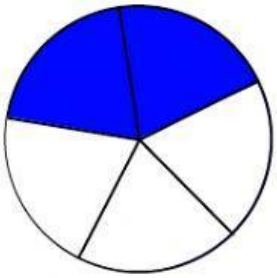

$\frac{2}{5}$

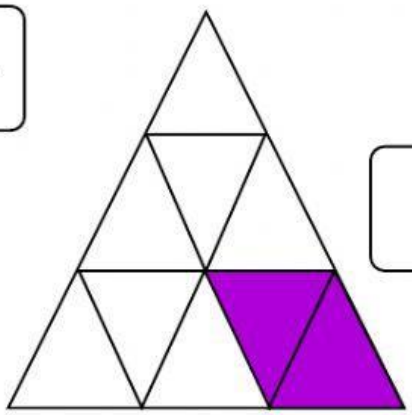



$\frac{1}{4}$