ACTIVIDAD PRÁCTICA

Escoge la opción correcta teniendo en cuenta la hora del reloj analógico.

11:35	18:10	17:45	20:30	12:05
7:55	14:30	9:30	08:25	12:55
11:25	05:30	05:45	18:40	11:55

¿Qué hora es?



....

Elige la respuesta correcta

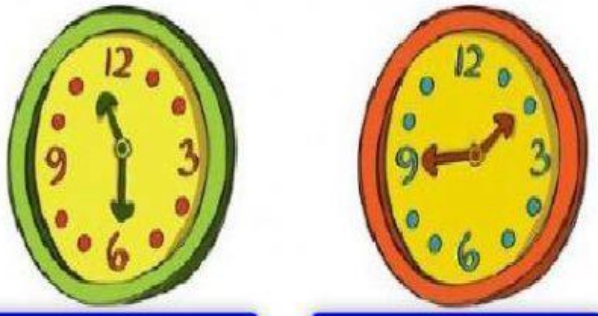

....

Elige la respuesta correcta

Son las diez menos diez	Son las tres y media
Son las diez y diez	Son las doce y media
Son las diez y media	Son las doce en punto
Son las diez en punto.	Son las tres en punto

Elige el número correcto

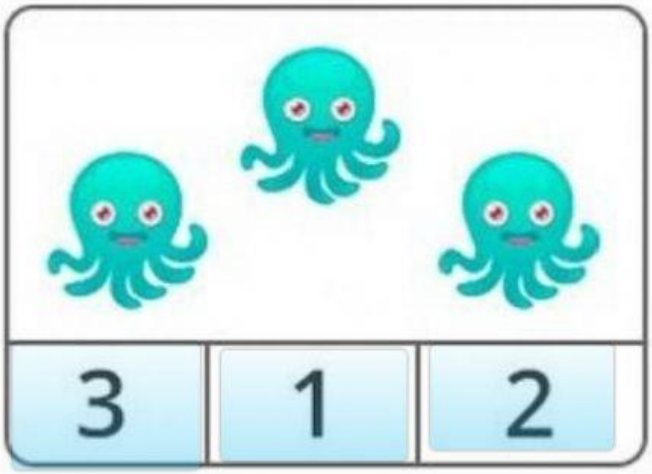

3	1	2

5	3	6

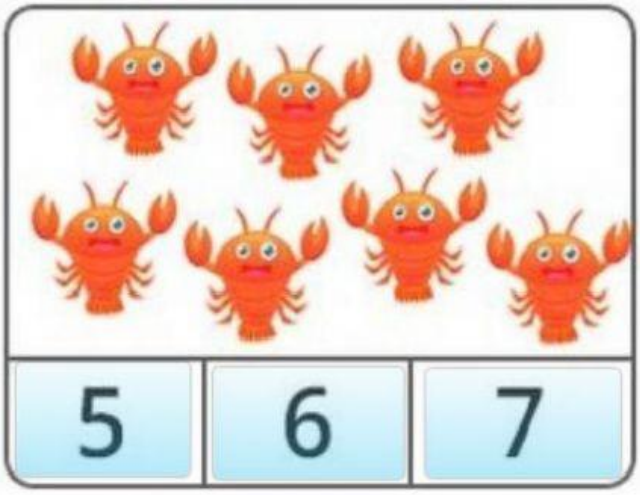

5	6	7



3	1	2

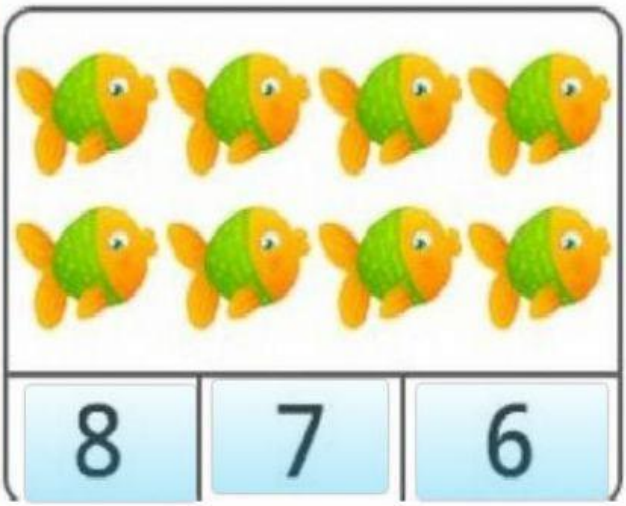

8	7	6

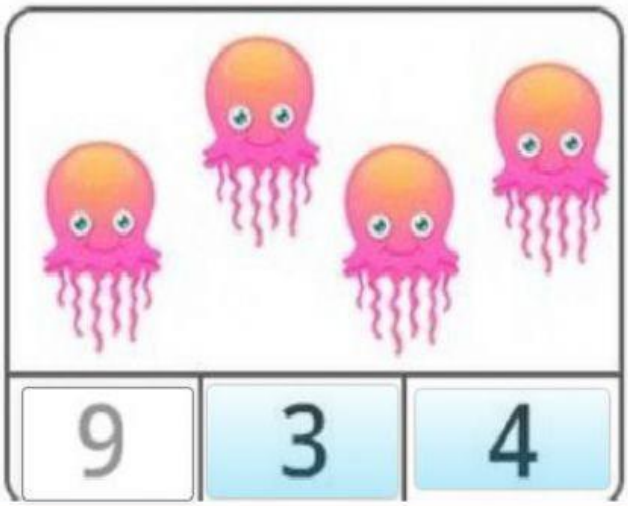

9	3	4