RIGHE E COLONNE

OSSERVA CIASCUNO SCHEMA E RISPONDI ALLE DOMANDE

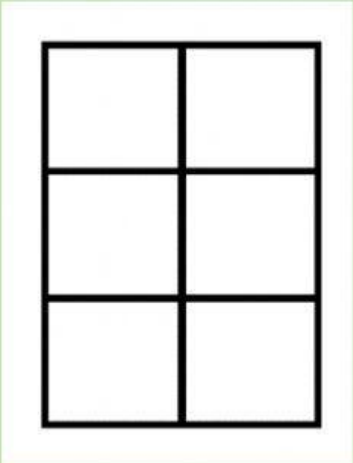

QUANTE RIGHE?

QUANTE COLONNE?

QUANTE CASELLE?

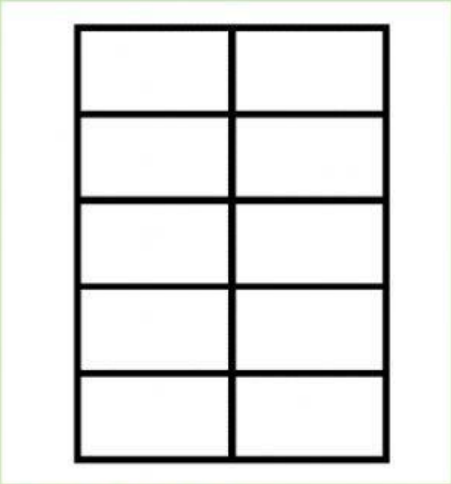

QUANTE RIGHE?

QUANTE COLONNE?

QUANTE CASELLE?



QUANTE RIGHE?

QUANTE COLONNE?

QUANTE CASELLE?

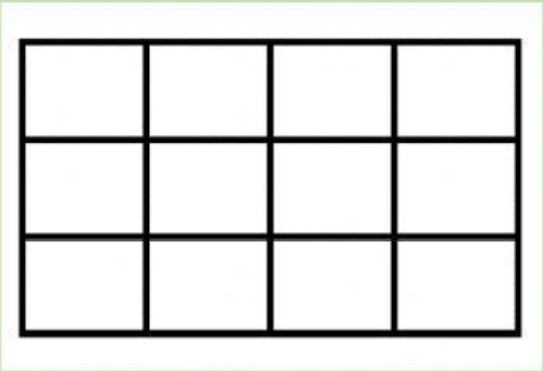

QUANTE RIGHE?

QUANTE COLONNE?

QUANTE CASELLE?