Prismas y Pirámides

Identifique el siguiente Prisma:

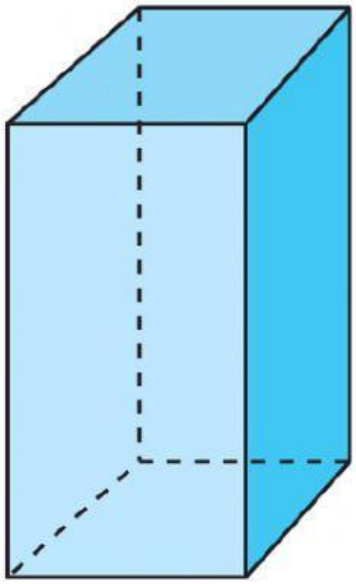

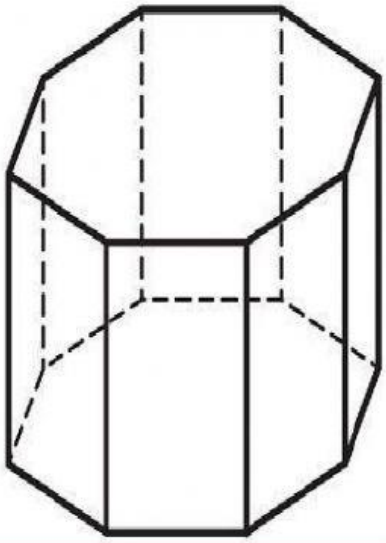

Calcula el ÁREA total y volumen del siguiente Prisma y distingue qué tipo de Prisma es.

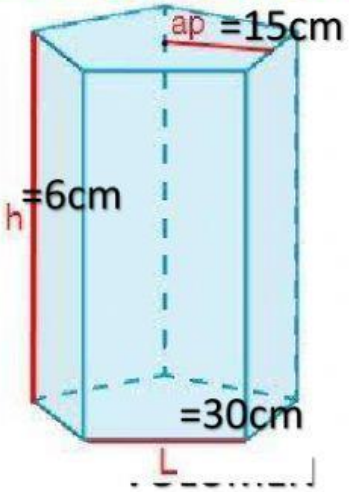

$V = Áb * h$

$V = \quad *$

$V = \quad cm^2$

AREA DE BASE

$Á = \frac{P * ap}{2}$

$Áb = \frac{*}{2}$

$Áb = \frac{}{2}$

$Áb = \quad cm^2$

$Áb = \quad * 2b$

$Áb = \quad cm^2$

ÁREA LATERAL

$Ál = P * h$

$Ál = \quad *$

$Ál = \quad cm^2$

ÁREA TOTAL

$Át = Ál + 2 * Áb$

$Át = \quad +2 \ *$

$Át = \quad +$

$Át = \quad cm^2$

Distingue que tipo de pirámide es:

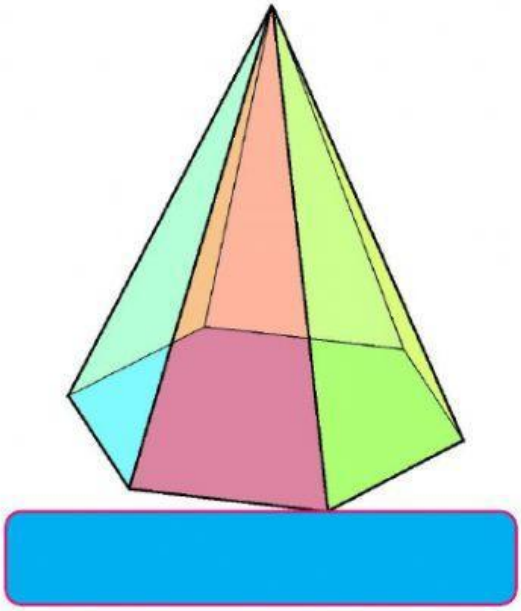

Relacione según corresponda el poliedro:

Prisma Pentagonal

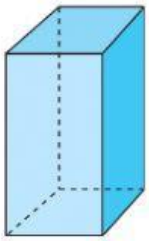

Pirámide Hexagonal

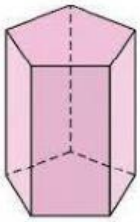

Prisma Cuadrángular