Evaluación Primero

1.-Completa.

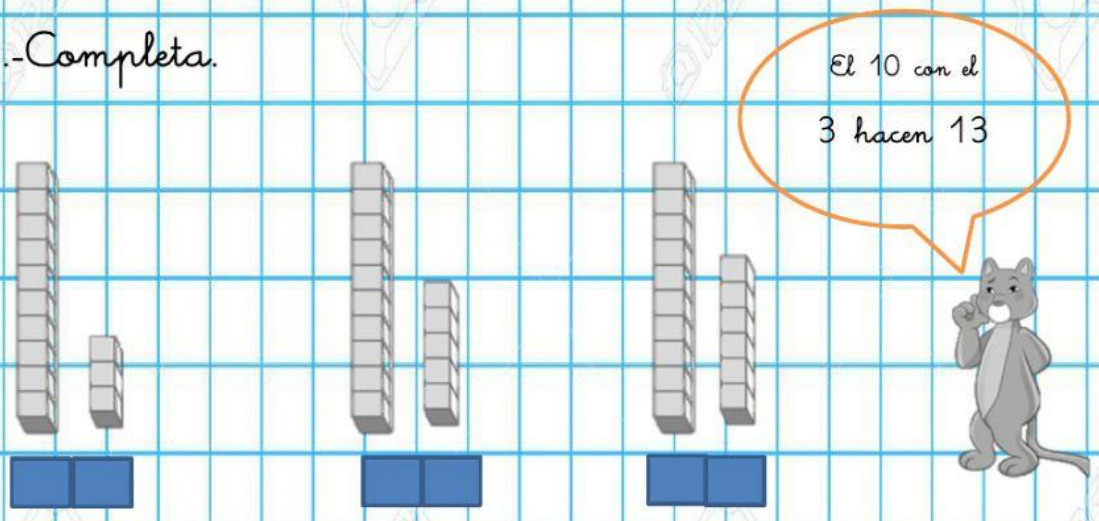

2.-Completa.

a.-10 y 1 hacen ☐

b.- 10 y 7 hacen ☐

c.- 10 y 8 hacen ☐

d.- 10 y ☐ hacen 20

3.-Une

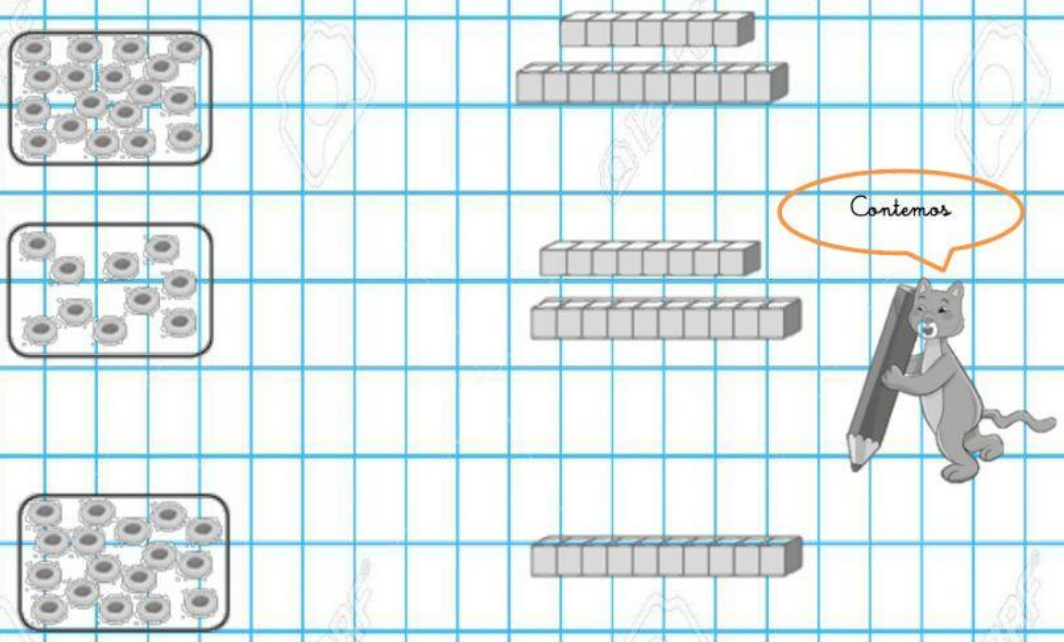

4.¿Cuántos hay?

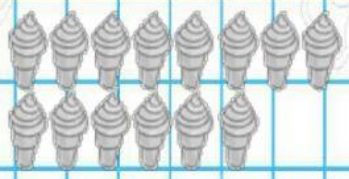

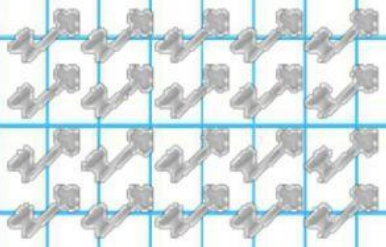



5.Marca el mayor:

10 8

12 14

6.-Completa:

15 ☐ 17 18 ☐ 20

☐ 11 12 13 ☐ 15

7. Observa y luego contesta.

17	12	13	11
19	18	15	16

El número mayor es

El número menor es