Workshop GOAL 2 – Dot Plot

Mr. Numael Guerrero Pérez
Sixth Graders
September 2020

1. Drag the words to complete the mind map of dot plot .

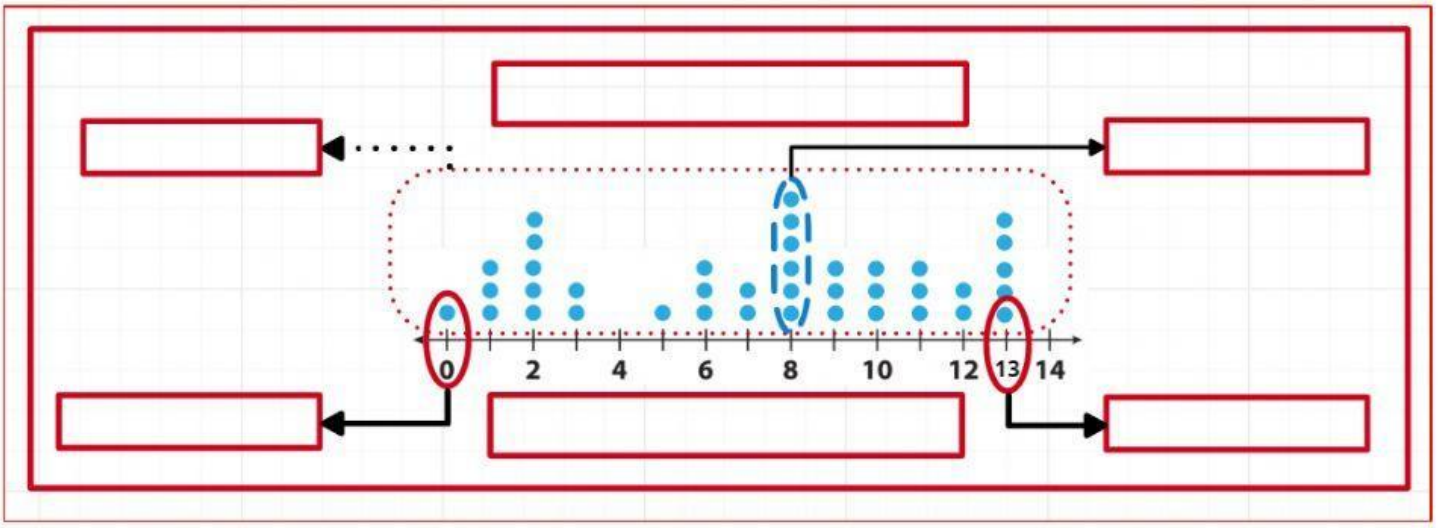

Frequency	Label	Mode
Greatest	Title	Least

2. Find the range and the mean of each exercise.

27, 13, 35, 19, 71, 12, 66, 47, 39

Median=

Greatest=

Least=

Range =

Mean = $\frac{\text{Total +}}{\text{N°data}}$ =

97, 106, 99, 97, 115, 95, 108, 100

Median=

Greatest=

Least=

Range =

Mean = $\frac{\text{Total +}}{\text{N°data}}$ =

3. Find the mode, median and range of each dot plot.

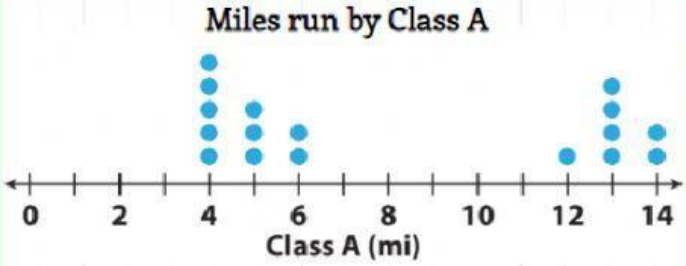

PLOT FORM mode = _____ mi

PLOT CENTER median = _____ mi

PLOT SPREAD range = _____ mi

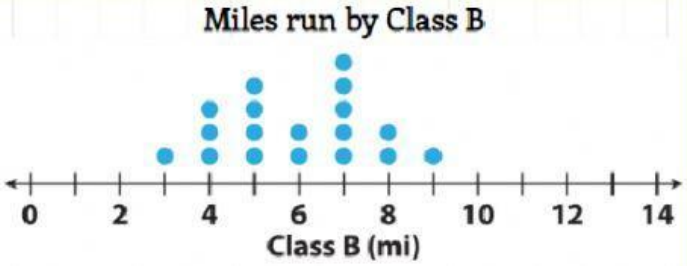

PLOT FORM mode = _____ mi

PLOT CENTER median = _____ mi

PLOT SPREAD range = _____ mi

4. According to the previous results, drag the classes names to make the sentence *truth*

PLOT FORM The _____ has a greater mode than _____ | Class A | Class B

PLOT SPREAD The data spread of _____ is shorter than _____ | Class A | Class B