	Which way does the box move? **Left / Right**		The force to the right is ____N The force to the left is _____N The resultant force is _____N to the **left / right**
	The box is: **Moving left / moving right / standing still**		The resultant force is _____N This means the box is **accelerating / decelerating / moving at a constant speed**
	The box is moving **Left / right** The resultant force is 5N to the **left / right**		The resultant force is _____N. This means the box is moving to the **right / left / standing still**
	The force to the left is ____N The force to the right is ____N The resultant force is 10N to the **left / right**		Create your own example