Vertical Addition

Count the images in each box. Print the answer under the line.

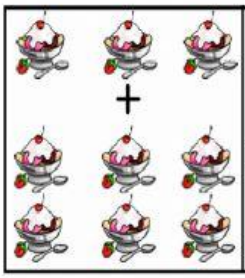

$$\begin{array}{r} 3 \\ +\ 6 \\ \hline \end{array}$$

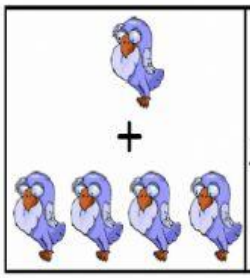

$$\begin{array}{r} 1 \\ +\ 4 \\ \hline \end{array}$$

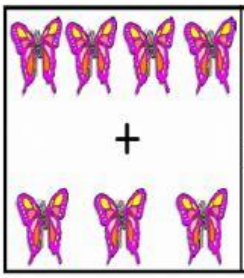

$$\begin{array}{r} 7 \\ +\ 3 \\ \hline \end{array}$$



$$\begin{array}{r} 1 \\ +\ 9 \\ \hline \end{array}$$



$$\begin{array}{r} 3 \\ +\ 4 \\ \hline \end{array}$$

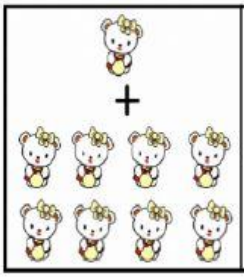

$$\begin{array}{r} 1 \\ +\ 8 \\ \hline \end{array}$$