Name: Grade 5

Prime Factorization

Complete the following factor trees

1 ) 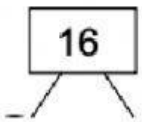


2 ) 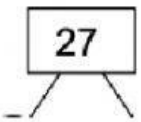


3 ) 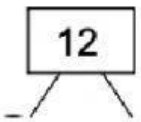


Work these out on paper and fill in the answers below

Prime Factors
_ x _ x _ x _ = 16

Prime Factors
_ x _ x _ = 27

Prime Factors
_ x _ x _ = 12

(Least to greatest)

4 )


5 ) 


6 ) 


Work these out on paper and fill in the answers below

Prime Factors
_ x _ x _ x _ = 40

Prime Factors
_ x _ x _ = 70

Prime Factors
_ x _ x _ = 18

(Least to greatest)