Guía repaso perímetro, área y volumen

1. ***Calcula el perímetro y el área de cada figura***

P=
A=

P=
A=

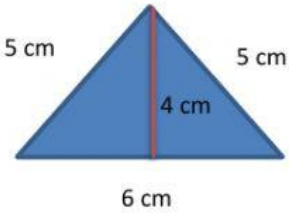

P=
A=

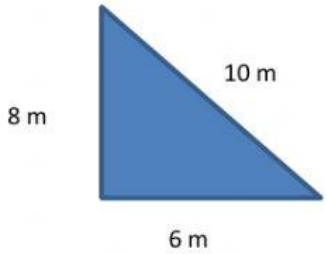

P=
A=

2. ***Calcula el área total y el volumen de los cuerpos geométricos.***

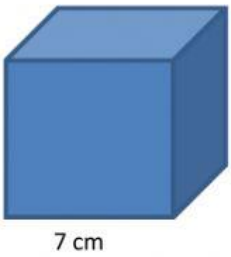

A=
V=

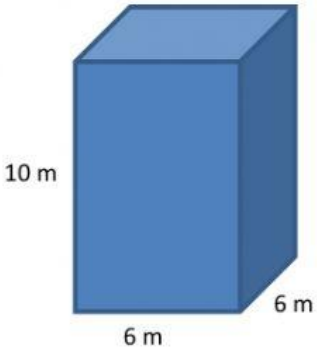

A=
V=

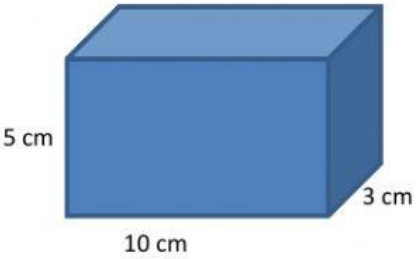

A=
V=