Arrays - Multiplication

TASK 1

Complete the multiplication sentence for the given arrays.

1)

4 × ☐ = 8

2)



☐ × 3 = 9

3)

☐ × 5 = 15

4)

2 × ☐ = 10

5)



4 × ☐ = 16

6)

☐ × 3 = 12

TASK 2

Write the multiplication sentence for each array given below.

1)



____ × ____ = ____

2)

____ × ____ = ____

3)

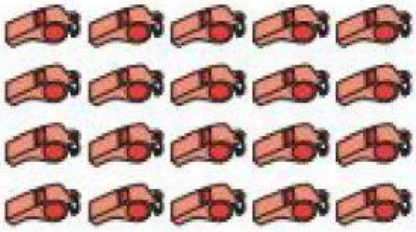

____ × ____ = ____

4)



____ × ____ = ____

5)

____ × ____ = ____

6)

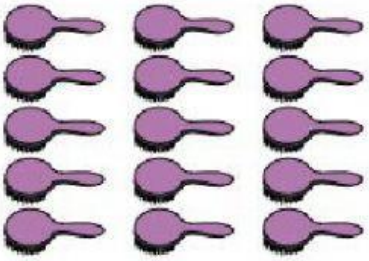

____ × ____ = ____

7)

____ × ____ = ____

8)

____ × ____ = ____

TASK 3 (Optional)

Draw Arrays for the following multiplication sentences in the notebook.

1. 3 x 6 =

2. 4 x 7 =