Agosto 31, 2020

Dividing Regions into Equal Parts

Reteaching
12-1

Un área puede ser **dividida en partes iguales** de maneras diferentes.

2 partes iguales
mitades

3 partes iguales
tercios

4 partes iguales
cuartos

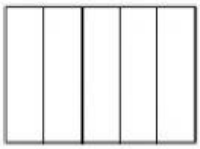

5 partes iguales
quintos

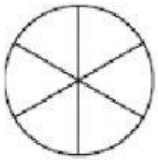

6 partes iguales
sextos

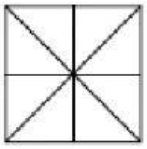

8 partes iguales
octavos

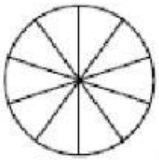

10 partes iguales
décimos



12 partes iguales
doceavos

Escribe si las figuras tienen **partes iguales** o **desiguales**.

1.



_____

2.

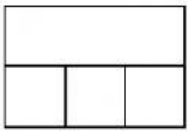

_____

3.

_____

4.

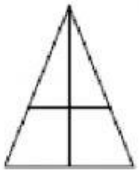

_____

5.

_____

6.

_____

Selecciona el **nombre** correcto en cada figura.

1.

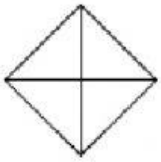

_____

2.

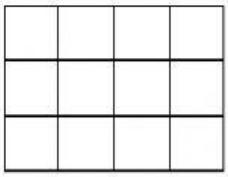

_____

3.

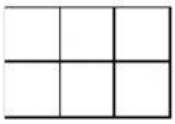

_____

4.

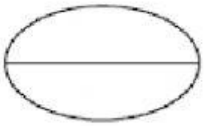

_____

5.

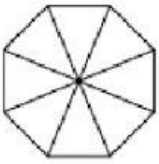

_____

6.

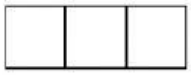

_____

7.

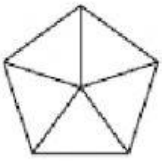

_____

8.

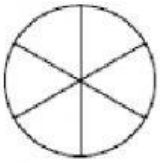

_____

9.



_____

10.

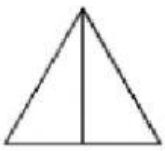

_____

11.



_____

12.

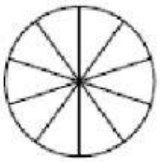

_____

Complete las siguientes **tablas de multiplicar.**

2 x 6 = _____ 7 x 6 = _____ 10 x 6 = _____

4 x 3 = _____ 6 x 5 = _____ 1 x 8 = _____