Name:_____

Which is the odd one out? Circle the letter.

Example



a b (c) d

1



a b c d

2

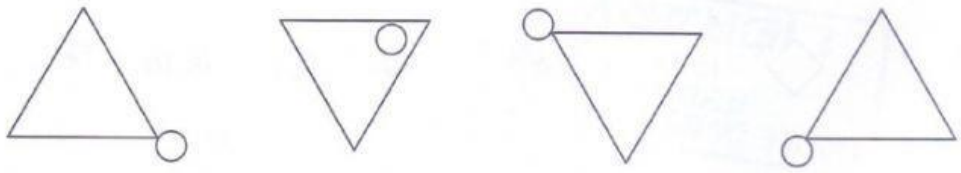

a b c d

3



a b c d

4



a b c d

5

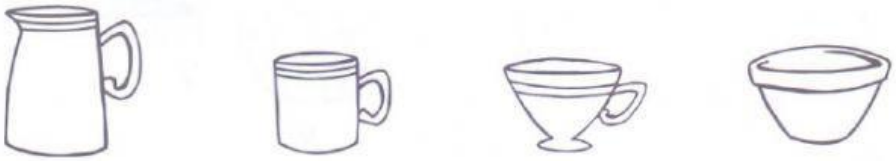

a b c d

Which one is the same as the one on the left? Circle the letter.

Example



6



7

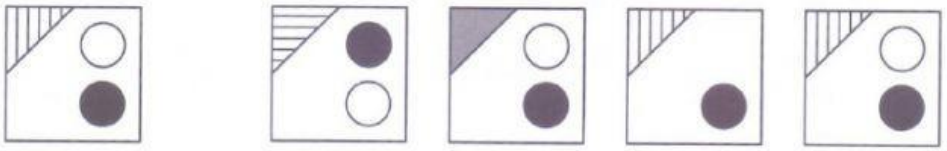

8



9

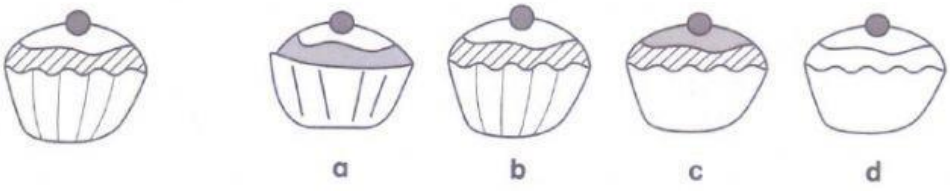

10

