iv. Determine the type of food each of the following animals eats. Use the word bank to help you.

Only plants	Only animals	Both plants and animals



eats_____



eats_____



eats_____

eats_____

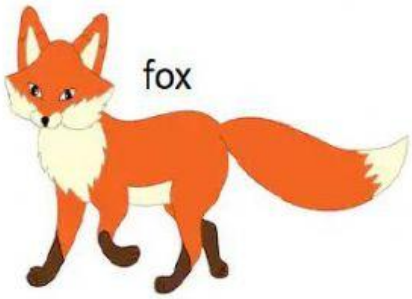

eats_____

sheep



eats_____