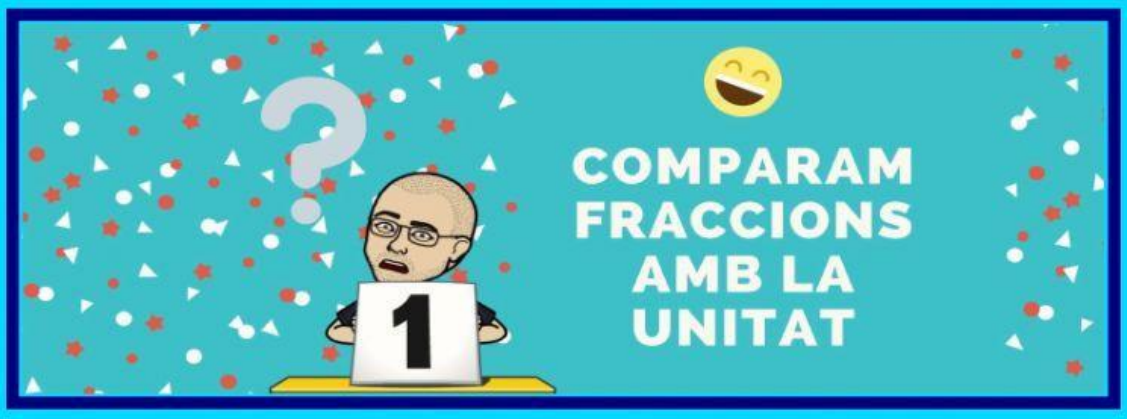


1. **Compara aquestes fraccions amb la unitat.** **Clica el que sigui més gros. Si són iguals, clica'ls tots dos:**

**a)** $\frac{2}{4}$ 1 **b)** $\frac{1}{3}$ 1 **c)** $\frac{5}{5}$ 1 **d)** $\frac{5}{8}$ 1

**e)** $\frac{7}{7}$ 1 **f)** $\frac{5}{3}$ 1 **g)** $\frac{2}{3}$ 1 **h)** $\frac{8}{5}$ 1

2. **Escriu una fracció per a cada apartat. Completa les informacions:**

**a) Taronges:**



- Què li hem fet a les taronges?:
- Quants trossos hi ha en total?
- Fracció: ___

**b) Pizzes:**

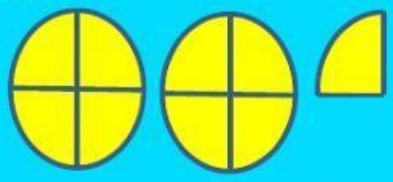

- Què li hem fet a les pizzes?:
- Quants trossos hi ha en total?
- Fracció: ___

**3. Escriu la fracció que falta acolorir en cada figura:**

a) 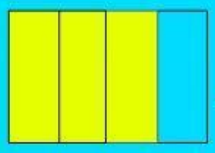 = ___

b) 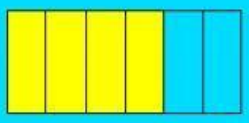 = ___

c) 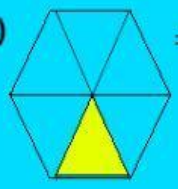 = ___

d) 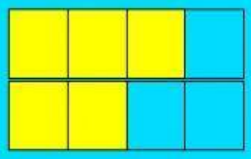 = ___

e) 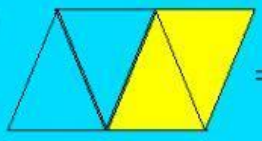 = ___