1. Identifique los desarrollos de los sólidos y escriba la letra adecuada.

(1)

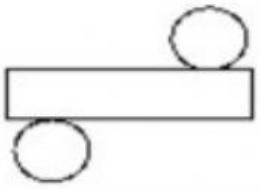

R:

(2)

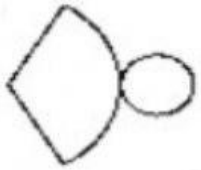

R:

(3)

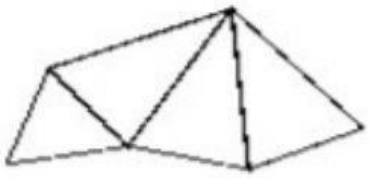

R:

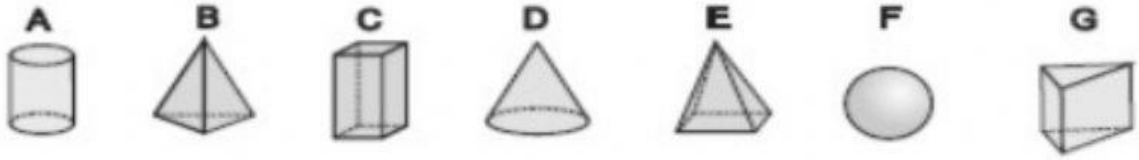

2. Escriba qué sólido se obtendrá cuando se gire cada figura plana.

(1) (2)

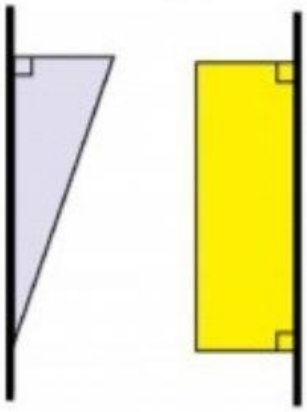

(1) _____

(2) _____

3. ¿Qué forma tiene cada una de las bases de este sólido?

R: