Name: _____ **Grade**: **3**

Mathematics

Place Value

Write the number for the base ten blocks below.

1. 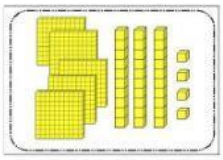

---

2. 

---

3. 

_____

4. **Write the value of the underlined digit of each number.**

4<u>5</u>6 _____ <u>**5**</u> 786 _____ <u>**3**</u>47 _____

6 3<u>**5**</u>1 _____ <u>**2**</u>95 _____ 8 32<u>**7**</u> _____

5. **Write the place of the underlined digit of each number.**

<u>**8**</u>93 _____ 7 <u>**5**</u>86 _____ <u>**4**</u>37 _____

<u>**5**</u> 631 _____ 5<u>**2**</u>9 _____ <u>**7**</u> 823 _____