1. Vertader o fals:

a) Un poliedre té una única base, diferent de la reta de cares:

b) Un poliedre té dues bases, diferents de la resta de cares:

c) Un poliedre regular té totes les cares iguals, no té bases diferents:

d) Només hi ha 3 polígons regulars:

e) Només hi ha 4 polígons regulars:

f) Només hi ha 5 polígons regulars:

2. Clica les formes que tenen les cares dels polígons regulars:

triangles quadrats rectangles pentàgons hexàgons

3. Eligeix el nom de les parts d'aquests dos poliedres regulars:

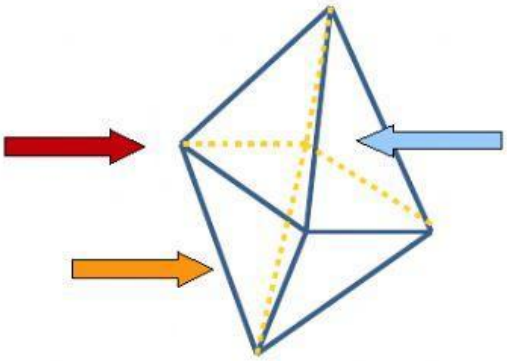

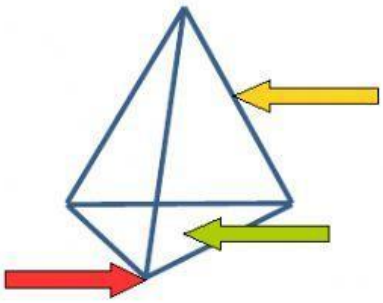

4. Clica les figures que SÍ són polígons regulars:

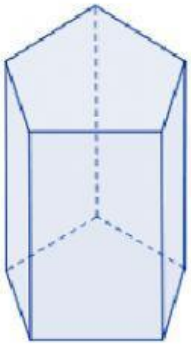

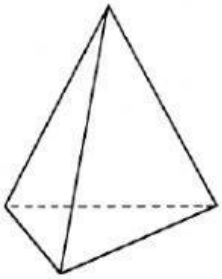

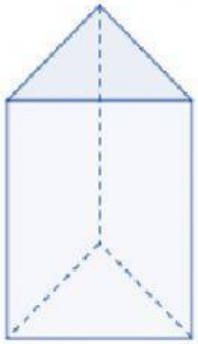

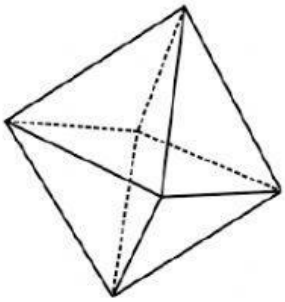

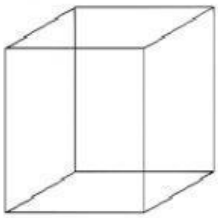

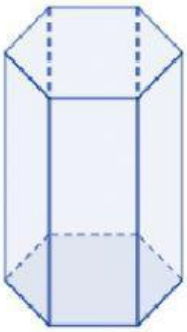

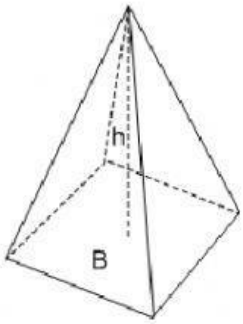

4. Aquí veus alguns desenvolupaments plans d'alguns poliedre regulars. Relaciona cada desenvolupament amb el poliedre regular que li correspon:

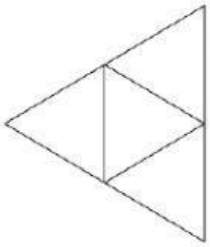
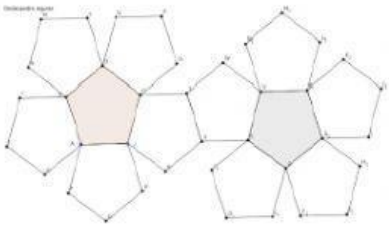
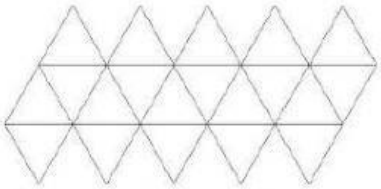

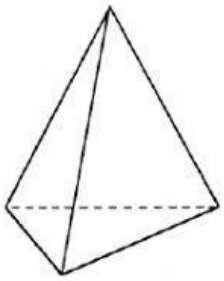
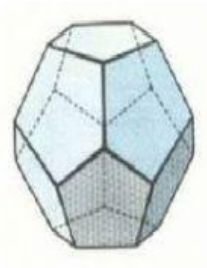

5. Completa aquesta taula:
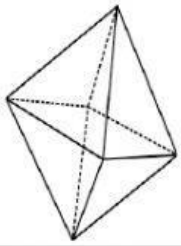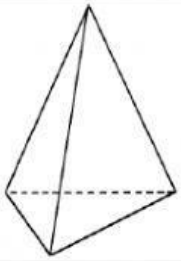
Dibuix	Nº cares	Forma polígon de les cares	Nom del poliedre regular: