LA TABLA DEL TRES

Observa las imágenes y escribe los números

_____ + _____ = _____

_____ x _____ = _____

____ + ____ + ____ = ____

_____ x ____ = _____



____ + ___ + ___ + ___ = _____

_____ x _____ = _____



___ + ___ + ___ + ___ + ___ = _____

_____ x _____ = _____



___+___+___+___+___+___ = ____

_____ x _____ = _____



__+__+__+__+__+__+__ =___

_____ x _____ = _____



__+__+__+__+__+__+__+__=___

_____ x _____ = _____

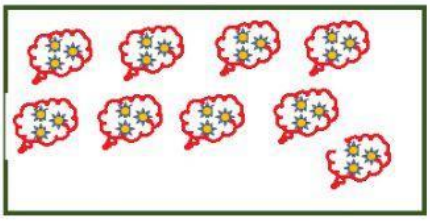

__+__+__+__+__+__+__+__+__=___

_____ x _____ = _____