1. Identifico cada elemento del círculo y coloco cada segmento en la tabla según corresponda.

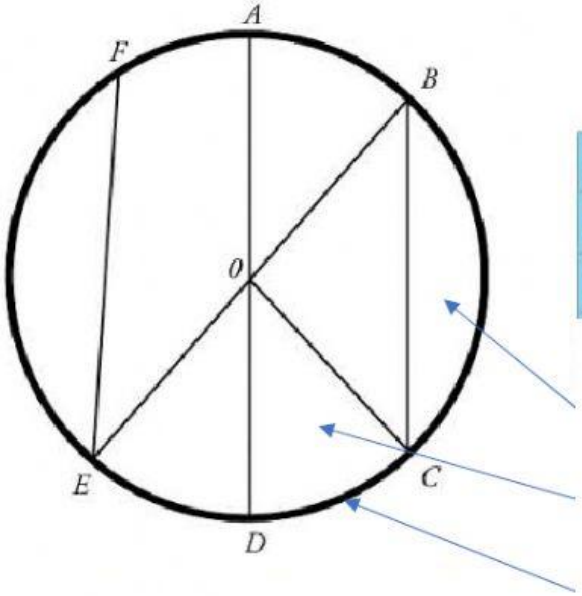

Radios	
Cuerdas	
Diámetros	

Segmentos Circular

Sector Circular

Arco

Segmentos:

$\overline{OA}$ $\overline{OB}$ $\overline{OC}$ $\overline{OD}$ $\overline{OE}$

$\overline{AD}$ $\overline{BE}$ $\overline{EF}$ $\overline{BC}$

2. Calcula el perímetro del círculo conociendo su radio o su diámetro.

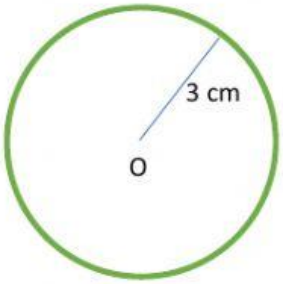

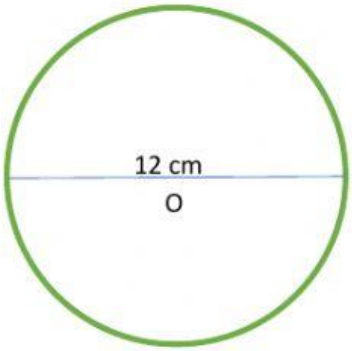

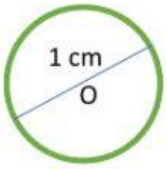

L= cm

L= cm

L= cm