GEOMETRÍA: CUADRILÁTEROS

SELECCIONA LA RESPUESTA ADECUADA:
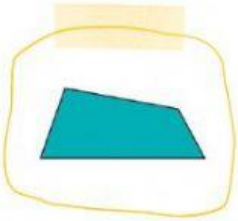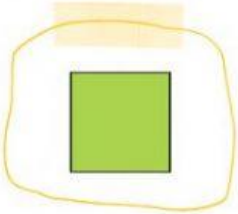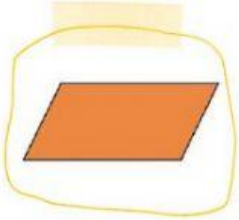
	NOMBRE	CANTIDAD DE LADOS	CANTIDAD DE ÁNGULOS	¿ES PARALELOGRAMO?