ENCUENTRA LA MEDIDA DE CADA BARRA. ESCRIBIR LA LONGITUD EN LAS UNIDADES DE MEDIDAS SOLICITADAS

1) 

cm → mm

2) 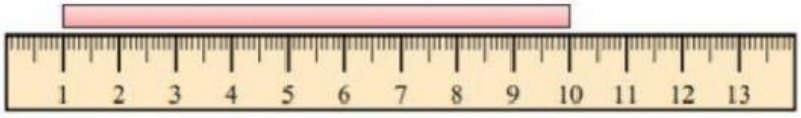

dm → m

3) 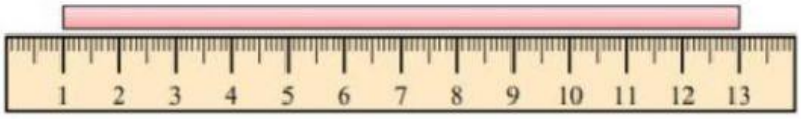

cm → dm

4) 

cm → mm

5) 

mm → cm

6) 

cm → dm

7) 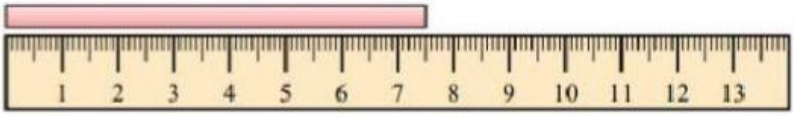

mm → cm

8) 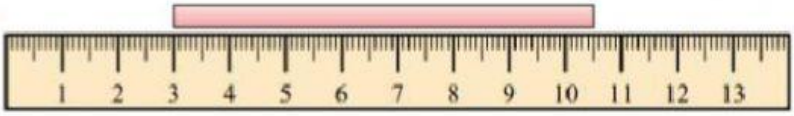

dm → cm

9) 

mm → cm

10) 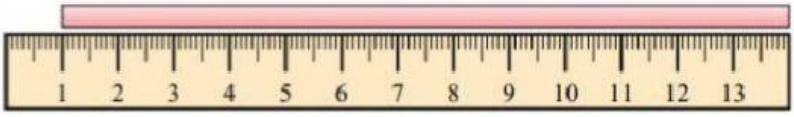

dm → m