Title: Drag forces 1 – air resistance

2 June, 2017
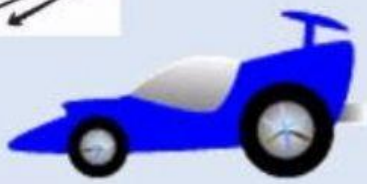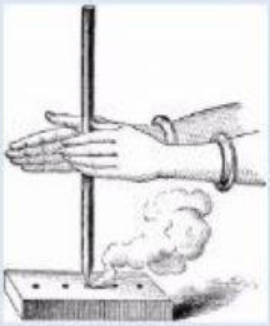
Bell work: Which of these images represent **drag** forces?