MATEMATIK

MENGENAL SUDUT

Namakan sudut yang ditunjukkan oleh anak panah dibawah

NO	SOALAN	JAWAPAN
1		
2	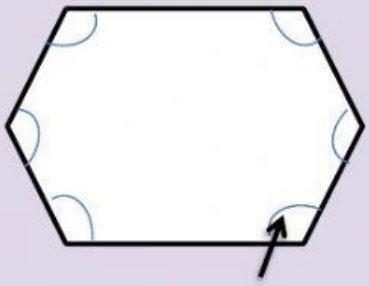	
3	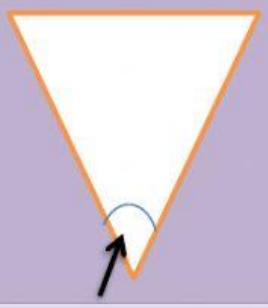	
4	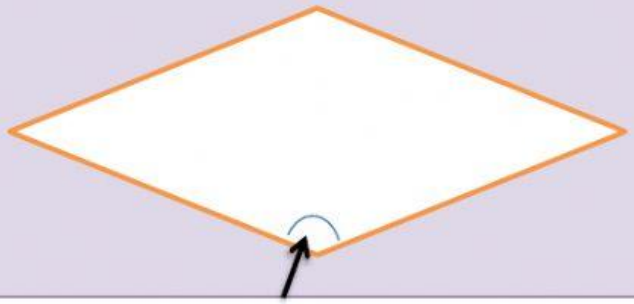	

NO	SOALAN	JAWAPAN
5	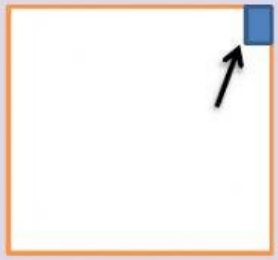	
6		
7	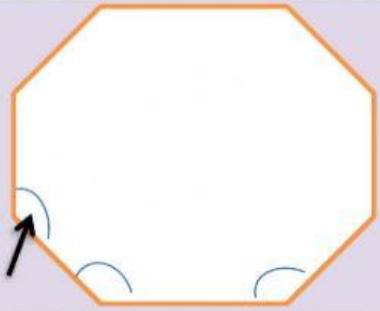	
8		

☺SELAMAT MENCUBA☺

TCER RENA 2020