Name _____ M- Fractions 3

Use the picture to answer each question.

What fraction of the shape is ***red*** ?

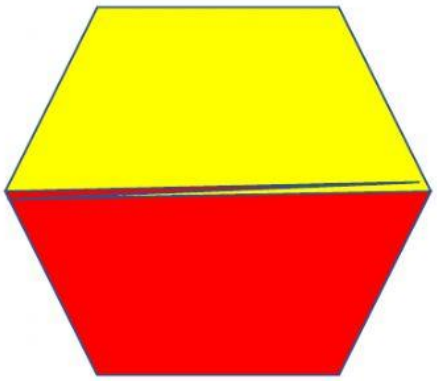

Remember, the numerator is the part we are focusing on

Remember, the denominator is ***all*** the parts

What fraction of the shape is ***green*** ?

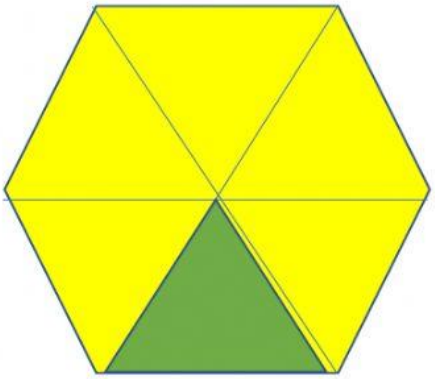

What fraction of the shape is ***blue*** ?

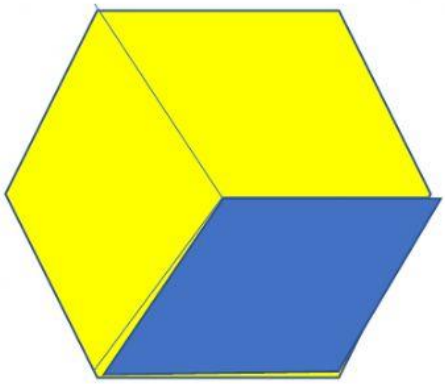

_____

What fraction of the (above) shape is ***yellow*** ?

_____

Parents, siblings, helpers,

Please take a minute to fill out this "Exit Slip" to help us assess the level of understanding for this assignment.

1 – Student needed to have the answers fed to them.

2- Student needed a lot of help to arrive at the correct answer.

3- Student needed just a little help to arrive at the correct answer.

4- Student completed the task independently. (Technical issues aside)

Enter a number here _____

Relationship to the student _____

Questions? Comments? (use this space)

_____

Thank You - Remember: "Email my answers to my teacher"