UNIT 1: Whole Numbers 1
Lessons: 1, 2, 3, 4, 5

Name: _____ **Date:** _____

Q1. Count and write the number in the box.

a.

b.



c.



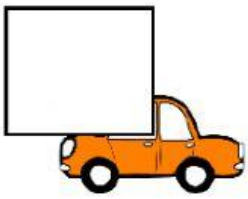

Q2. Fill in the missing numbers.



Q3. Write backward counting from 20 – 11.



Q4. Count in 2s and write the correct answer.

a. How many flowers are there?
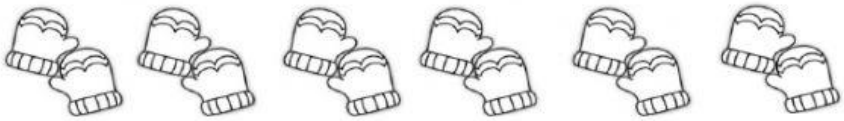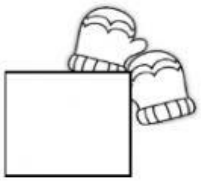
b. How many mittens are there?