1) **Observa i completa**

a)



Quants globus hi ha en total? 5 x 3 = ...



Quants globus hi ha en total? ☐ x ☐ = ☐



Quants globus hi ha en total? ☐ x ☐ = ☐



Quants globus hi ha en total? ☐ x ☐ = ☐

Multiplica

$$\begin{array}{r} 30 \\ \times\ 5 \\ \hline \square\square \end{array} \qquad \begin{array}{r} 22 \\ \times\ 5 \\ \hline \square\square \end{array} \qquad \begin{array}{r} 41 \\ \times\ 5 \\ \hline \square\square \end{array} \qquad \begin{array}{r} 10 \\ \times\ 5 \\ \hline \square\square \end{array}$$

$$\begin{array}{r} \square\,28 \\ \times\ 5 \\ \hline \square\square \end{array} \qquad \begin{array}{r} \square\,13 \\ \times\ 5 \\ \hline \square\square \end{array} \qquad \begin{array}{r} 80 \\ \times\ 5 \\ \hline \square\square \end{array} \qquad \begin{array}{r} \square\,19 \\ \times\ 5 \\ \hline \square\square \end{array}$$

$$\begin{array}{r} \square\,43 \\ \times\ 5 \\ \hline \square\square \end{array} \qquad \begin{array}{r} \square\,14 \\ \times\ 5 \\ \hline \square\square \end{array} \qquad \begin{array}{r} \square\,35 \\ \times\ 5 \\ \hline \square\square \end{array} \qquad \begin{array}{r} \square\,36 \\ \times\ 5 \\ \hline \square\square \end{array}$$