FUNCIONES CUADRÁTICAS

Relaciona las siguientes funciones expresadas algebraicamente con su representación gráfica.
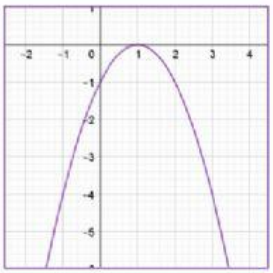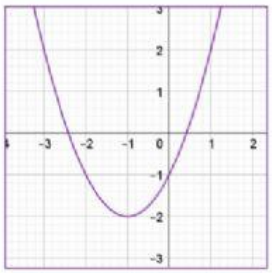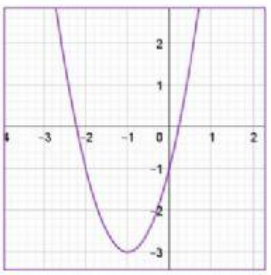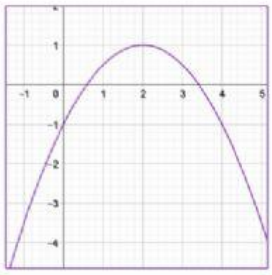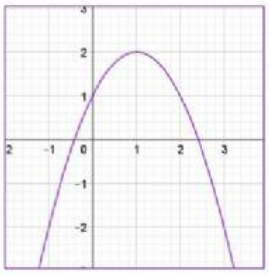
$x^2 + 2x - 1$ $\quad -x^2 + 2x + 1$ $\quad -x^2 + 2x - 1$ $\quad -0,5x^2 + 2x - 1$ $\quad 2x^2 + 4x - 1$